小数の意味と表し方４ 13

◎ 水のかさをぬる

日にち：　　月　　日

名まえ

1　水のかさだけ色を ぬりましょう

① 1.6 L

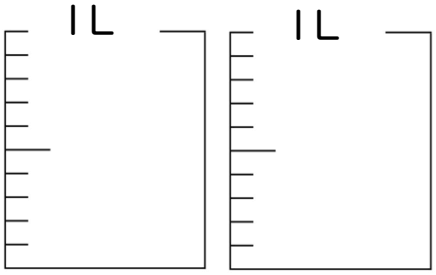

② 1.5 L

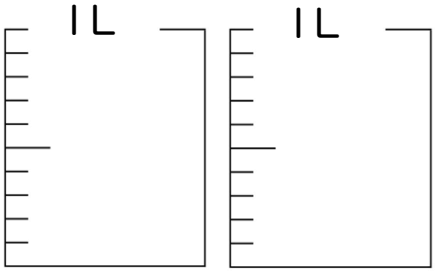

③ 0.4 L

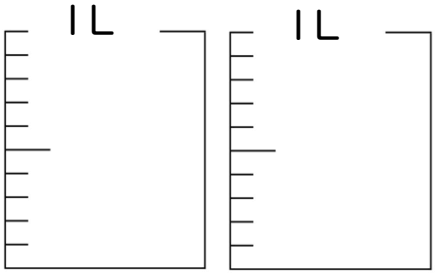

④ 1.9 L

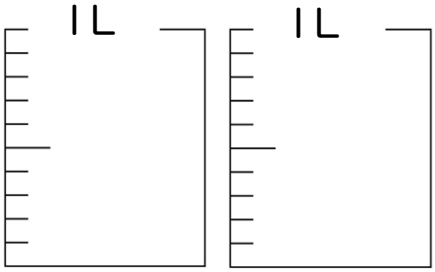

2　水のかさは、何Lでしょう

①

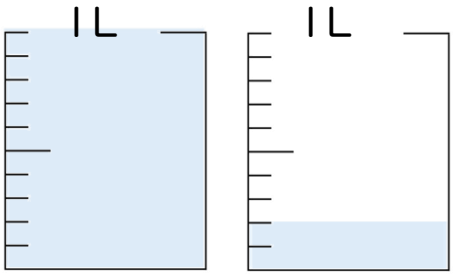

答え　　L

②

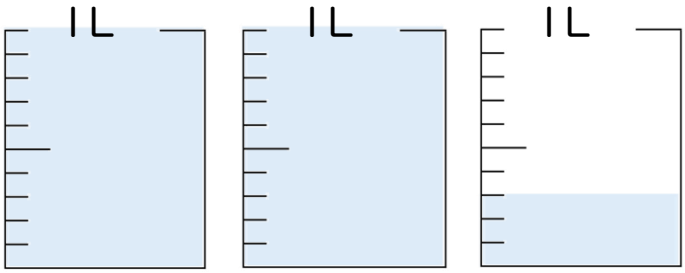

答え　　L

すらすらぷりんと

小数の意味と表し方４ 13

◎ 水のかさをぬる

日にち：　　月　　日

名まえ

1　水のかさだけ色を ぬりましょう

① 1.6 L

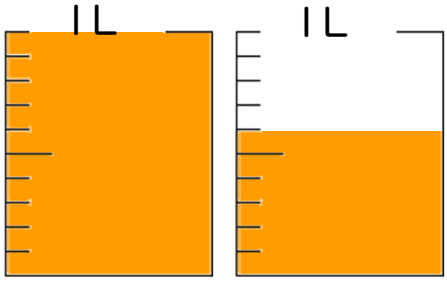

② 1.5 L

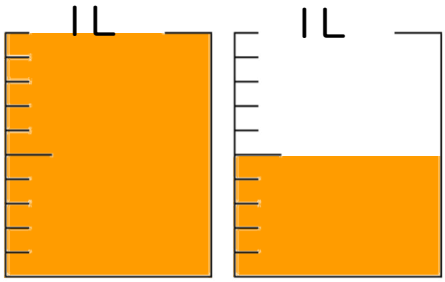

③ 0.4 L

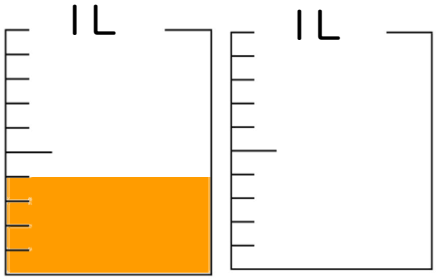

④ 1.9 L

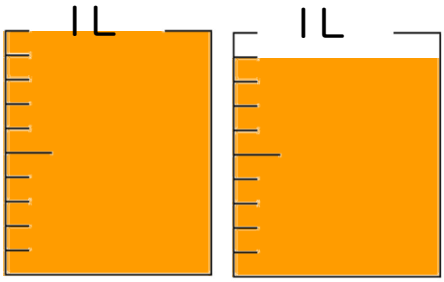

2　水のかさは、何Lでしょう

①

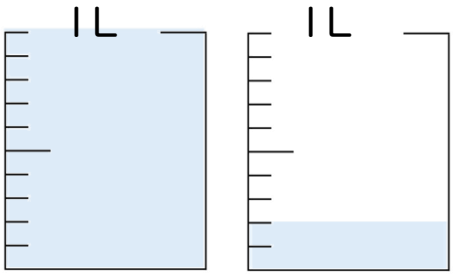

答え　1.2 L

②

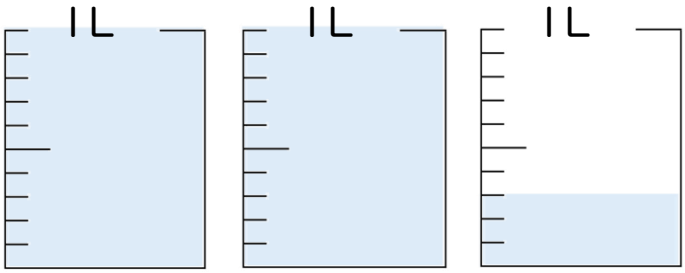

答え　2.3 L

すらすらぷりんと