分数 2

◎ 分数の長さの読み取り 14

日にち：　　月　　日

名まえ

・色をぬったところの長さは、何mでしょう。

①

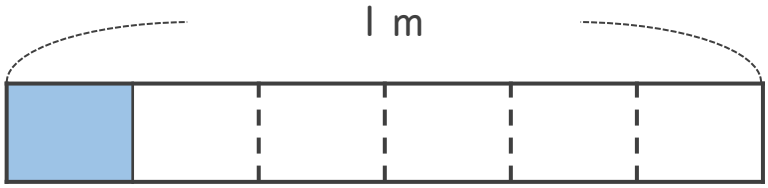

こたえ：　　m

②

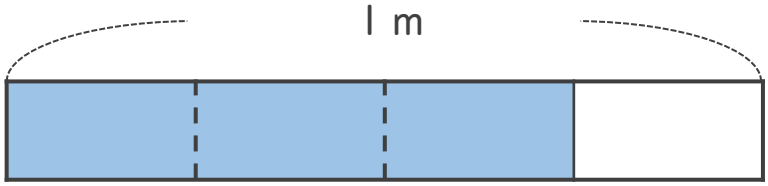

こたえ：　　m

③

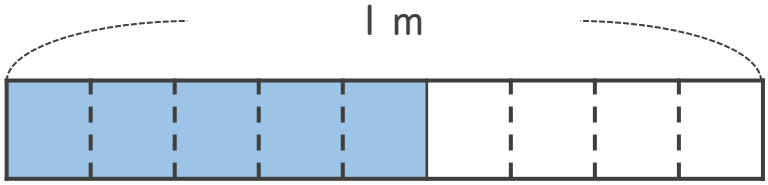

こたえ：　　m

④

こたえ：　　m

⑤

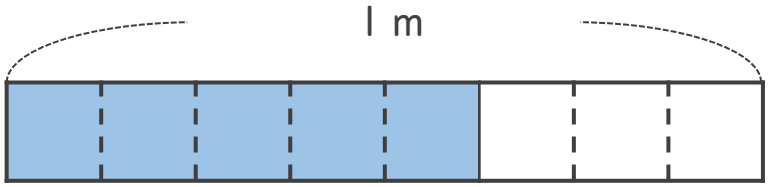

こたえ：　　m

⑥

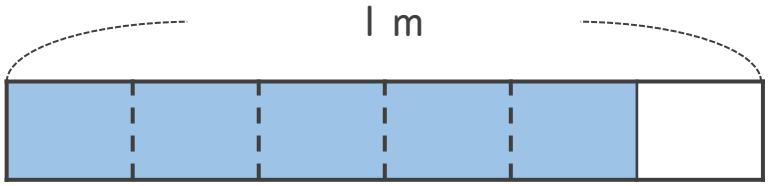

こたえ：　　m

⑦

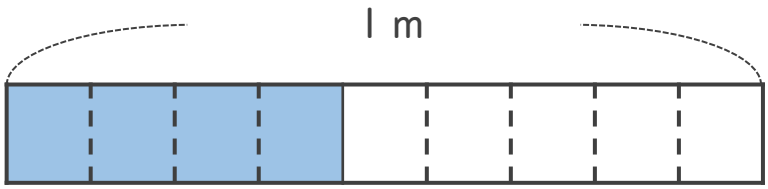

こたえ：　　m

すらすらぷりんと

分数 2

◎ 分数の長さの読み取り

14

日にち：　　月　　日

名まえ

・色をぬったところの長さは、何mでしょう。

①

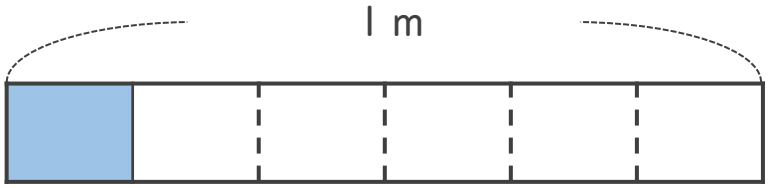

こたえ：$\frac{1}{6}$ m

②

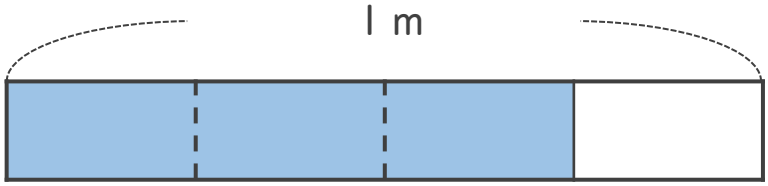

こたえ：$\frac{3}{4}$ m

③

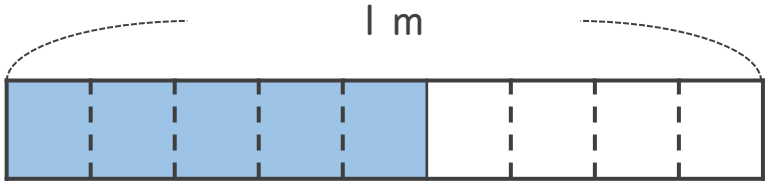

こたえ：$\frac{5}{9}$ m

④

こたえ：$\frac{2}{3}$ m

⑤

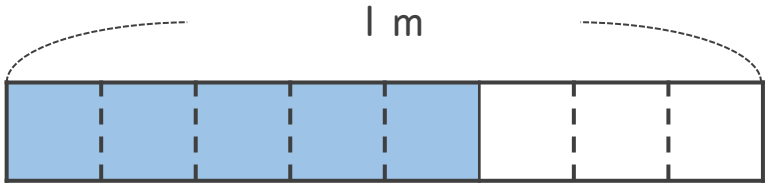

こたえ：$\frac{5}{8}$ m

⑥

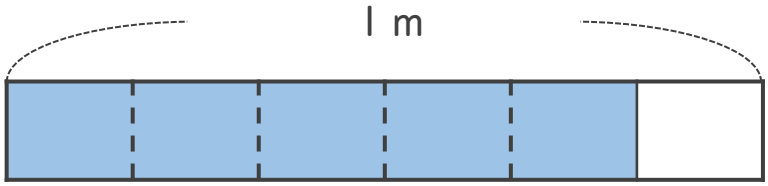

こたえ：$\frac{5}{6}$ m

⑦

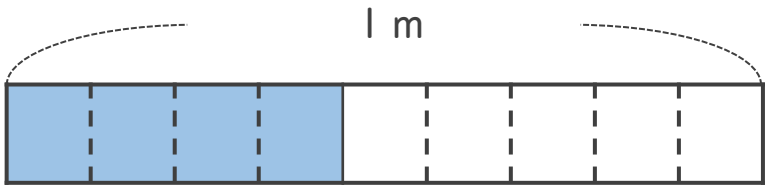

こたえ：$\frac{4}{9}$ m

すらすらぷりんと