小数の意味と表し方４ 16

◎ 水のかさをぬる

目指せ80点！

てん

名まえ

1 水のかさだけ色を ぬりましょう（各20点）

① 1.6 L

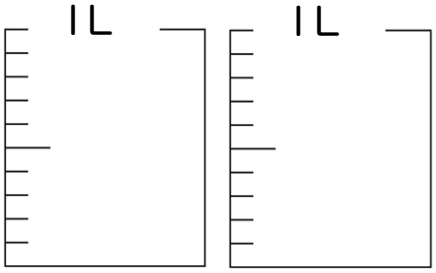

② 0.7 L

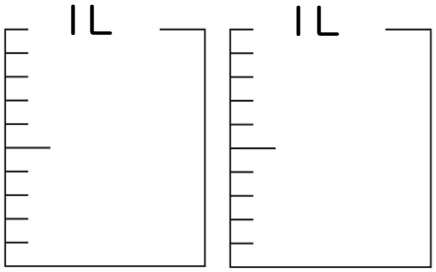

③ 2 L

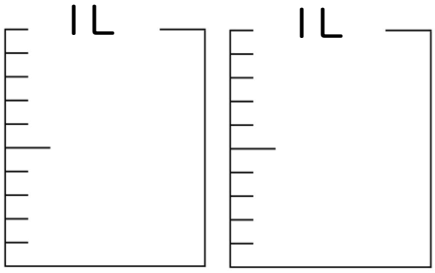

④ 1.8 L

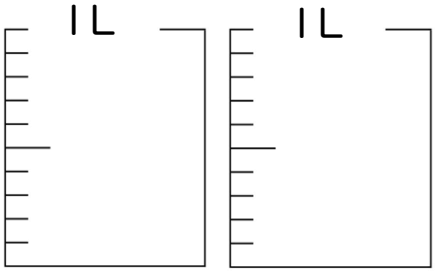

2 水のかさは、何Lでしょう （各10点）

①

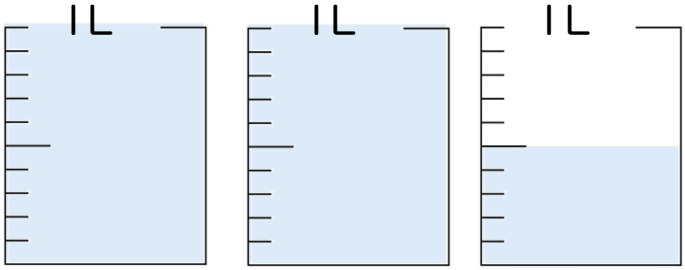

答え ＿＿＿＿ L

②

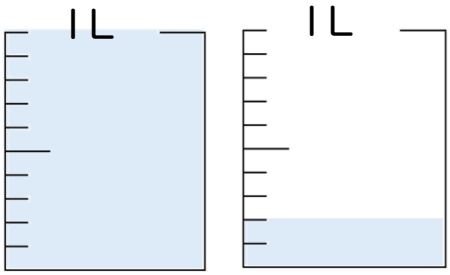

答え ＿＿＿＿ L

すらすらぷりんと

小数の意味と表し方４ 16

◎ 水のかさをぬる

目指せ80点！

てん

名まえ

1　水のかさだけ色を ぬりましょう（各20点）

① 1.6 L

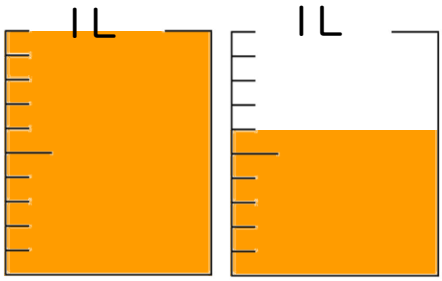

② 0.7 L

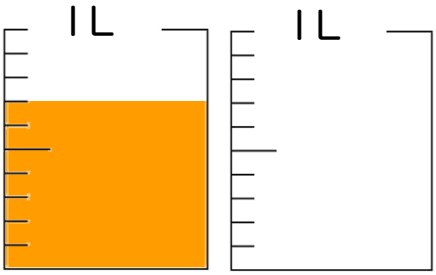

③ 2 L

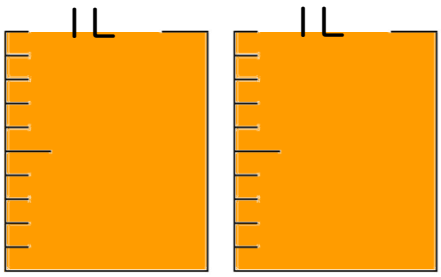

④ 1.8 L

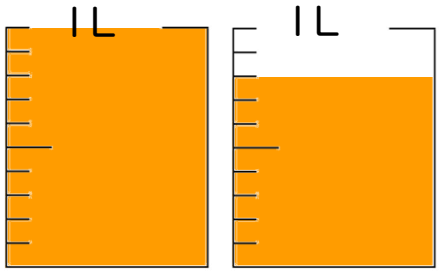

2　水のかさは、何Lでしょう （各10点）

①

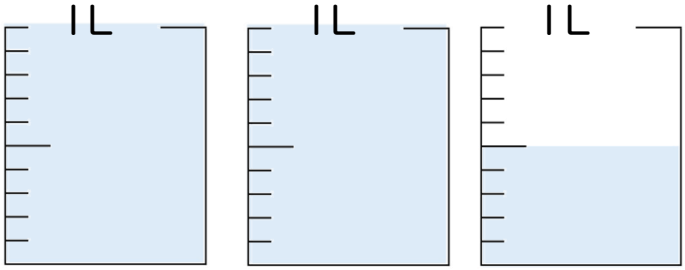

答え　2.5 L

②

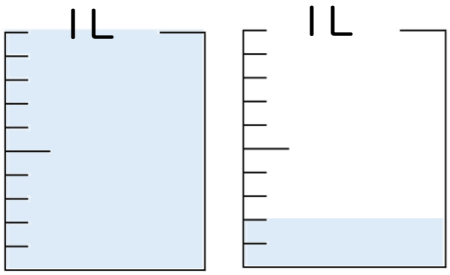

答え　1.2 L

すらすらぷりんと